Name: _____

Sr: 13122023-3411

December 13, 2023

MATHS WORKSHEET GENERATOR 11-PLUS SATS GCSES

1) b

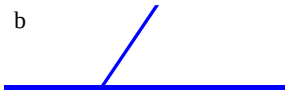

a o c

Measure angle boa

Answer: _____

2) 91 + 78

Answer: _____

3) Round 7.67833 to 4 decimal places.

Answer: _____

4) Round 7.67833 to 4 decimal places.

Answer: _____

5) 'What is the probability of rolling a multiple of 1.when rolling a dice

Answer: _____

6) (-27) x (-12)

Answer: _____

7) Convert the following fraction into a mixed number: $^{4}/_{2}$

Answer: _____

8) A number is chosen at random from 1 to 25. Find the probability of selecting number less than 8.

Answer: _____

9) Write 7000000000 in standard form.

Answer: _____

10)

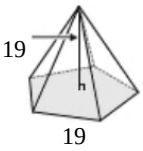

Find Volume of Pentagonal Pyramid

Answer: _____

11) Convert the following improper fraction $4^{2}/_{9} + 2^{1}/_{9}$ into a mixed number

Answer: _____

12) 120 ÷ 10

Answer: _____

13) Find the median of the following set of data:

10, 24, 19, 23, 9, 12, 28, 28, 12, 21

Answer: _____

14) $16\ ^{3}/_{12}$

Answer: _____

15)

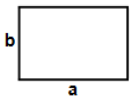

Find perimeter of rectangle having sides a = 100 cm and b = 93 cm

Answer: _____

Copyright 2023 - Geek School Tutoring Limited

Name: _____

Sr: 13122023-3411

December 13, 2023

MATHS WORKSHEET GENERATOR 11-PLUS SATS GCSES

16) Find the median of the following set of data:
39, 15, 31, 36, 40, 35

Answer: _____

17) Convert the following mixed number $9\frac{4}{9}$ into an improper fraction.

Answer: _____

18) Share 27 in the ratio 2:7

Answer: _____

19) 100 ÷ 10

Answer: _____

20) Find the mean of the following set of data:
0.6, 14, 10, 6

Answer: _____

Total: ___ / 20

Copyright 2023 - Geek School Tutoring Limited

Name: _____

Sr: 13122023-3411

December 13, 2023

Answers:

1) 124	2) 169	3) 7.6783	4) 7.6783	5) $^{1}/_{1}$	6)	7) 2
8) $^{7}/_{25}$	9) 7×10^{9}	10) 3933.5848302132	11) $6^{1}/_{3}$	12) 12	13) 10.5	14) 2
15) 386cm	16) 33.5	17) $^{85}/_{9}$	18) 3 : 24	19) 10	20) 7.65	

Copyright 2023 - Geek School Tutoring Limited